Year 5 Homework A – 10th May 2024

Remember to also have a go at TTRS, Spelling Shed and Lexia (if you have it)! All links are on the class page.

Forgotten your login? Let me know!

Reasoning



Is he correct? Explain your answer.

Ones	.	tenths	hundredths

Equivalent Fractions and Decimals

Write the fraction and decimal that matches these diagrams.

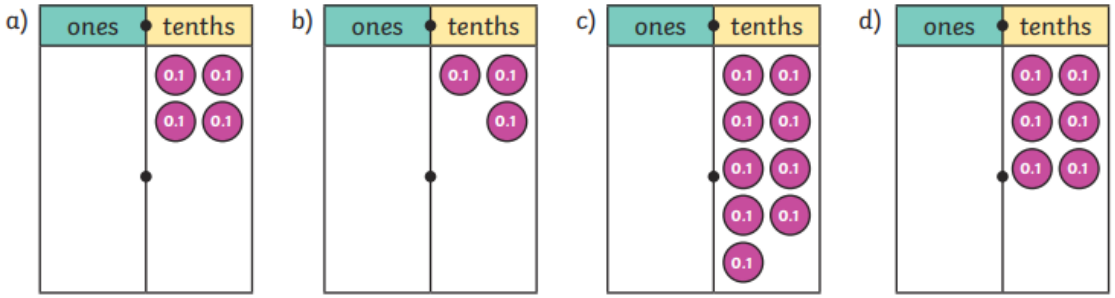

Co-ordinates

Plot the point on the coordinate grid.
Remember: X before Y!

A (7, 4) B (2, 6) C (9, 3) D (8, 1) E (10, 5)

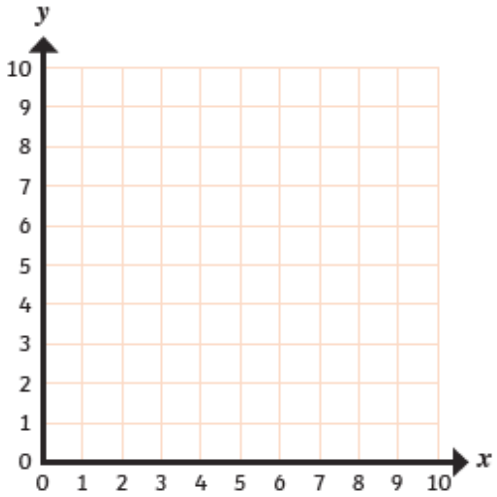

Time

Is she correct? Explain your answer.

Multiplication

7 x 4 = _____.	8 x 7 = _____.	48 ÷ 12 = _____.
9 x 2 = _____.	6 x 4 = _____.	56 ÷ 7 = _____.
4 x 9 = _____.	5 x 8 = _____.	33 ÷ 3 = _____.
10 x 12 = _____.	0 x 6 = _____.	798 ÷ 1 = _____.